Unit 10 TEST Name/Class_____

1 Write one note equal to the duration of the combined note values.

a. = _____

b. = _____

c. = _____

d. = _____

e. = _____

2–10

2 Complete each measure by adding one note above each arrow.



3–21

3 Complete each measure by adding one rest above each arrow.
Write the counts under the measures.

3–15



4 Add bar lines and a double bar to complete each example,
and write the counts under the measures.

a. 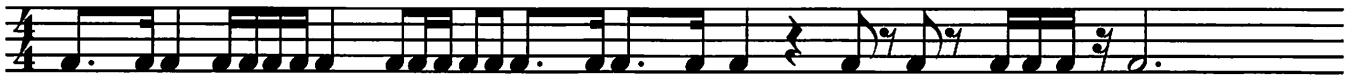

b. 

3–24

5 Add bar lines and a double bar to complete the example below.

Procession of the Nobles

Nicolai Rimsky-Korsakov
(1844–1908)

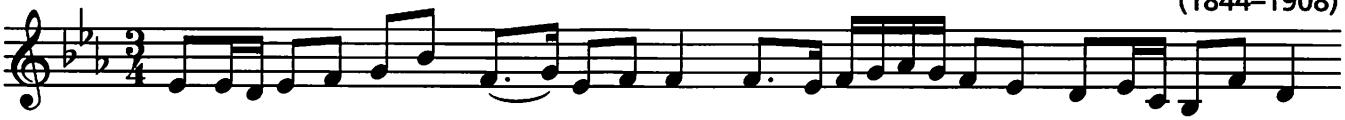

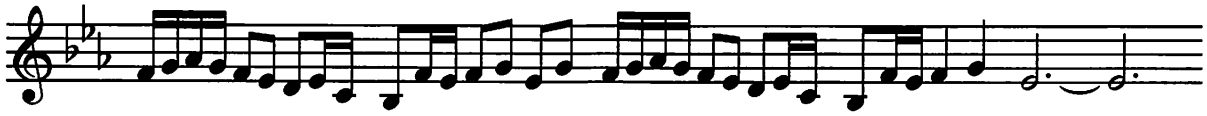

3–30

100

Copyright © MMII by Alfred Publishing Co., Inc.